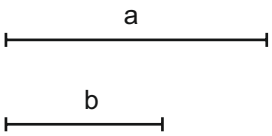

Add the segments *a* and *b* on a horizontal line.

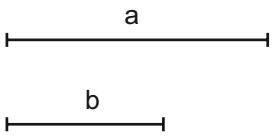

Substract the segment *b* from the segment *a*, on a horizontal line.

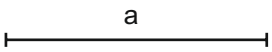

Multiply the segment *a* by four, on a horizontal line.



Divide the segment AB in two equal parts, drawing a perpendicular bisector.

Divide the segment AB in five equal parts, using the Thales' theorem.



OPERATIONS WITH SEGMENTS	Group:	Mark:
Name and surname:	Date:	